Zadanie 4

Michał waży 25 kg, jego starszy brat jest cięższy od niego o 5 kg. Ile waży brat Michała?

Obliczenia

Odpowiedź:

Zadanie 5

Zaznacz na termometrach temperatury podane poniżej.

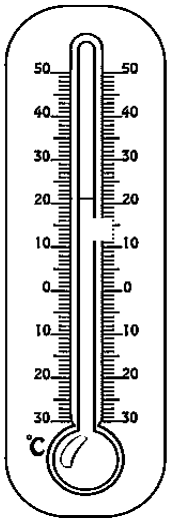

11 °C

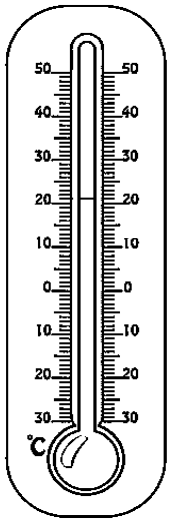

5 °C

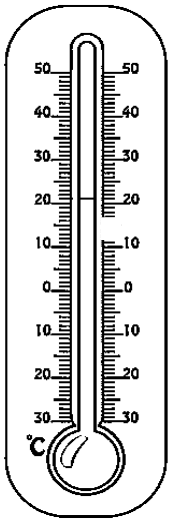

25 °C

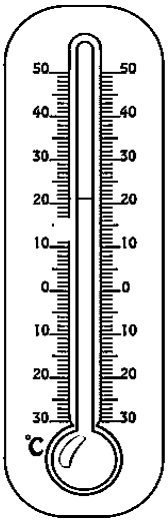

10 °C

Poniżej zera

- Otocz pętelką termometr z najwyższą temperaturą.

Zadanie 6

Oblicz

+9

5	**10**	**7**	**12**	**3**					
					20	**14**	**16**	**18**	**15**

-9